CLOCK

Telling Time — Half Hours · Sheet 3

Great job!

sticker here

Date _____

What time is it? Write the time.

Name _____

1.



_____ : _____

2.



_____ : _____

3.



_____ : _____

4.



_____ : _____

5.



_____ : _____

6.



_____ : _____

ANSWER

Telling Time — Half Hours · Sheet 3

What time is it? Write the time.

1) 12:30

2) 4:30

3) 9:30

4) 6:30

5) 10:30

6) 3:30